ثانيا: الرياضيات

1-حوّط حول خانة العدد الأكبر:

1	7	3	0	2	4	5	8	9	6

2- رتب الأعداد من الأصغر إلى الأكبر : 0-1- 3- 4- 7- 2- 9- 10- 5- 6- 8

0	.....	.....	.....	.....	.....	.....	.....	.....	.....	.....

3 -حوّط العدد المناسب كما في المثال:



4 -أكمل رسم القريصات الناقصة:



5 -لون القريصات حسب العدد:

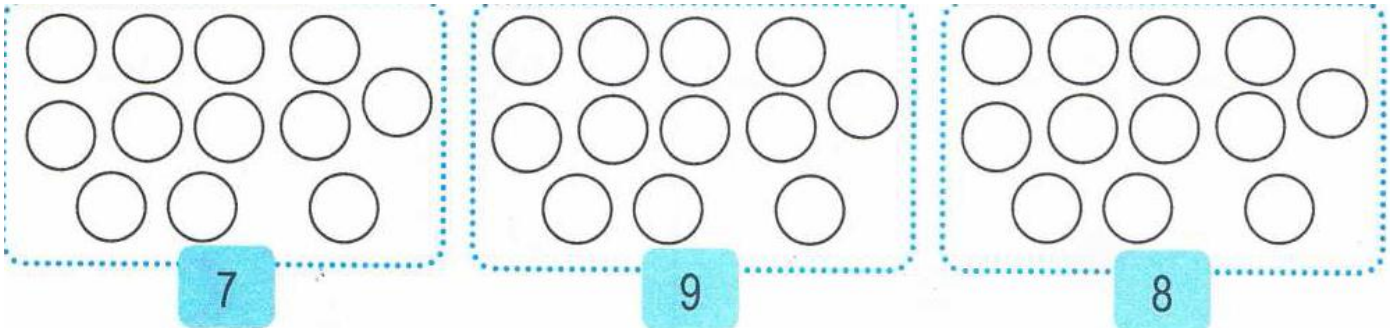

odrous.com

ثانيا: الرياضيات

1- أُكْتُبْ عَدَدَ عَنَاصِرِ كُلِّ مَجْمُوعَةٍ:

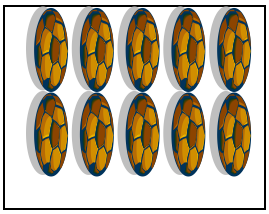

.....



.....



.....

2- احْسُبْ عَمَلِيَاتِ الْجَمْعِ:

2 + 1 = ...

6 + 4 = ...

4 + 1 = ...

3 -احْسُبْ عَمَلِيَاتِ الطَّرْحِ:

3 – 1 = ...

5 – 2 = ...

4 – 3 = ...

4 -أَرْبِطْ كُلَّ عَرَبَةٍ بِالرَّقْمِ الْمُنَاسِبِ:

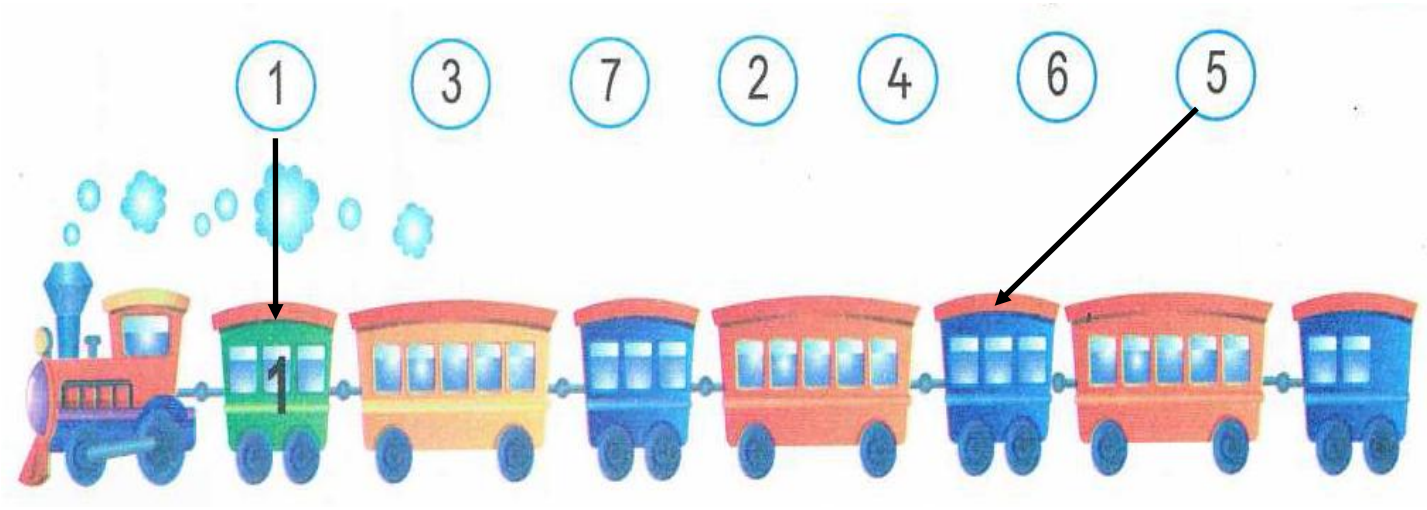

odrous.com

ثانيا: الرياضيات

1- أُكْتُبْ عَدَدَ عَنَاصِرِ كُلِّ مَجْمُوعَةٍ:

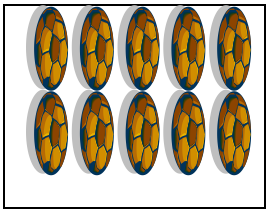

.....



.....



.....

2- لَوِّنْ بِطَاقَةَ الْعَمَلِيَّةِ الصَّحِيحَةِ :

10-3	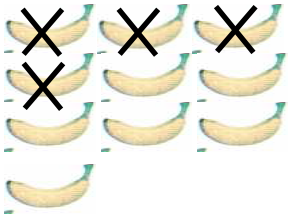	9-3	
6+4		9+3	
10-4		4+1	

3 -احْسُبْ عَمَلِيَاتِ الْجَمْعِ وَ الطَّرْحِ:

3 — 1 = ...
10 — 2 = ...
9 — 3 = ...

2 + 1 = ...
8 + 2 = ...
6 + 3 = ...

4 -أَكْمِلْ بِالْعَدَدِ الْمُنَاسِبِ:

..... + 2 = 3
5 + ... = 9
..... + 6 = 8

2 + ... = 10
..... + 3 = 9
6 + ... = 7

5 -لَوِّنْ طَرِيقَ اللَّبُؤَةِ لِلْعَوْدَةِ لِصَغِيرِهَا:

odrous.com

ثانيا: الرياضيات

1- أَكْمِلْ رَسْمَ الْقُرَيْصَات النَّاقِصَةِ:



14 17 19

2- أُكْتُبْ الْعَدَدَ فِي كُلِّ بِطَاقَةٍ :



....

3 -احْسُبْ عَمَلِيَاتِ الْجَمْعِ:

5 + 5 = ...

3 + 2 = ...

2 + 1 = ...

4 + 2 = ...

4 -احْسُبْ عَمَلِيَاتِ الطَّرْحِ:

3 – 1 = ...

10 – 2 = ...

2 – 1 = ...

8 – 2 = ...

5 -رَتِّبْ الدِّبَبَةَ مِنَ الْأَكْبَرِ إِلَى الْأَصْغَرِ:



..... 3 ....